Google Slides Lessons Preview

© Super Simple Sheets

Ontario Math Curriculum
Data Literacy & Probability – Grade 1

3-Part Lesson Format

Part 1 – Minds On!
- Learning Goals
- Discussion Questions
- Quotes
- And More!

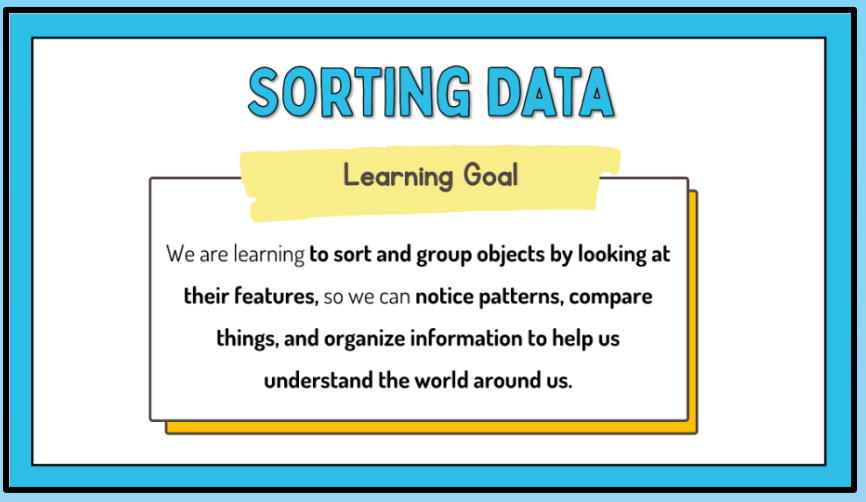

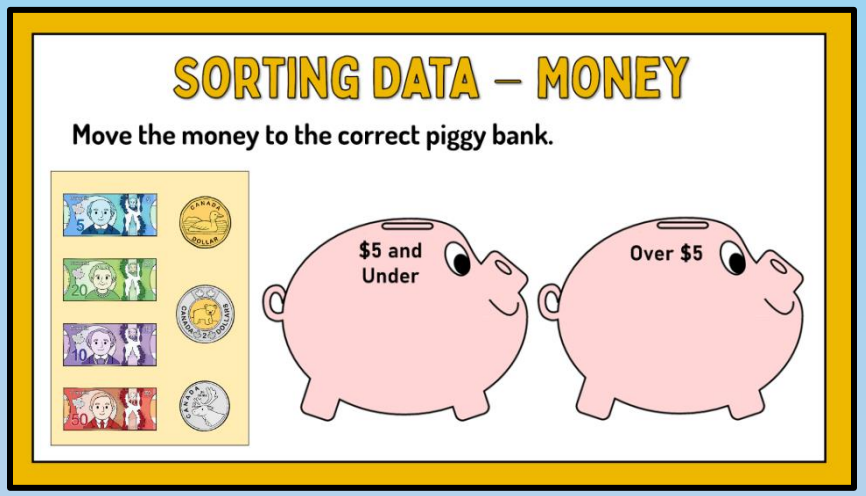

Part 2 – Action!
- Writing
- Matching
- Drag and Drop
- Drawing
- And More!

Part 3 – Consolidation!
- Exit Cards
- Quizzes
- Reflection
- And More!

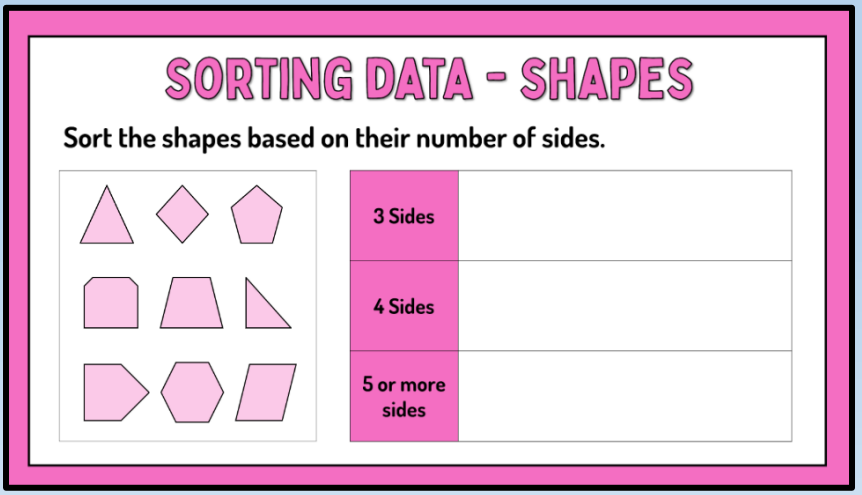

SUPER Simple SHEETS

Ontario Math Curriculum
Data Literacy & Probability – Grade 1



Ontario Math Curriculum
Data Literacy & Probability – Grade 1

PROBABILITY

Describe the likelihood of the events in the pictures. ✔



Possible / Impossible / Certain



Possible / Impossible / Certain



Possible / Impossible / Certain



Possible / Impossible / Certain



Possible / Impossible / Certain

Look at the spinner and answer the questions bel

1) What is the probability you land on blue?	
2) What is the probability you land on pink?	
3) What is the probability you land on purple?	
4) What is the probability you land on green, pink, or blue?	
5) What is the probability you land on pink or green?	

Certain

Possible

Impossible



S

A | B | C

Question	A	B	C	Answer
1) How many out of 10 **kids** would choose **ice cream** over broccoli?	3 out of 10	6 out of 10	9 out of 10	
2) How many out of 10 **adults** would choose **ice cream** over broccoli?	3 out of 10	6 out of 10	9 out of 10	
3) How many out of 10 **cats** would choose **sleeping** over taking a walk?	1 out of 10	5 out of 10	9 out of 10	
4) How many out of 10 **dogs** would choose **sleeping** over taking a walk?	1 out of 10	5 out of 10	9 out of 10	
5) How many out of 10 **kids** would choose **playing outside** over cleaning?	2 out of 10	7 out of 10	10 out of 10	
6) How many out of 10 **adults** would choose **playing outside** over cleaning?	2 out of 10	7 out of 10	10 out of 10	